152 One Hundred Fifty-two

☐ = ☐ hundreds + ☐ tens + ☐ ones

❶

_____	_____	_____	_____
_____	_____	_____	_____
_____	_____	_____	_____

I Can Do This

❷

7	14	8	14	5	13	6	13
+7	−7	+6	−5	+9	−6	+7	−9
_____	_____	_____	_____	_____	_____	_____	_____
_____	_____	_____	_____	_____	_____	_____	_____

❸

_____
_____
_____

❹ Write <, >, or =.

☐

❺ 1 yard = ____ inches

❻

4	☐13	☐	282	
4	53	525	203	959
+ 6	+ 27	+ 145	+ 213	− 236
____	____	____	____	____

❼

12 − 5 = ____	7 + 5 = ____	13 − 5 = ____	5 + 8 = ____
4 + 9 = ____	12 − 6 = ____	8 + 5 = ____	14 − 8 = ____

❽



9 What part is coloured?

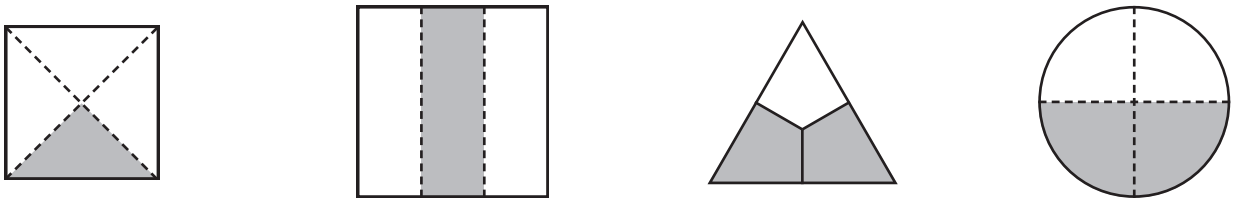

$\frac{1}{4}$	$\frac{1}{3}$	$\frac{3}{4}$	$\frac{1}{4}$	$\frac{1}{3}$	$\frac{1}{2}$	$\frac{2}{4}$	$\frac{3}{4}$	$\frac{2}{3}$	$\frac{2}{4}$	$\frac{2}{3}$	$\frac{1}{4}$
○	○	○	○	○	○	○	○	○	○	○	○

10 Solve the problems.

12 – 8 + 6 = ____ 7 + 6 – 4 = ____ 2 + 7 – 9 = ____

11 Write the amounts using a $ and decimal point.

23¢ = ____ **400¢ =** ____ **205¢ =** ____

12

13	7	14	9	14
– 7	+ 6	– 6	+ 5	– 9
____	____	____	____	____

13	14	6
– 8	– 7	+ 8
____	____	____

No New Facts

153 One Hundred Fifty-three

Write the missing numbers.

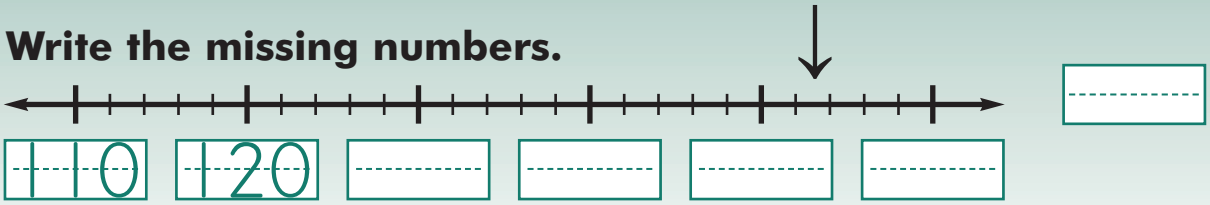

❶ **New Facts**

$6 + 9 = \square$

$9 + 6 = \square$

❷

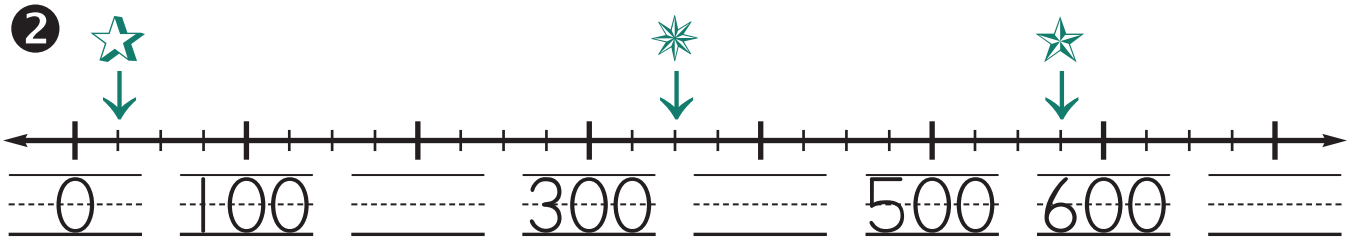

How many? ☆ _____ ✷ _____ ☆ _____

I Can Do This

❸

9	14	6	13	7	12	5	13
+ 6	− 7	+ 8	− 7	+ 6	− 7	+ 7	− 5
_____	_____	_____	_____	_____	_____	_____	_____

4 **Story Problem**

Eva and her family were walking in the woods. They saw eight clumps of violets and six clumps of spring beauties. How many clumps of wildflowers did they see?

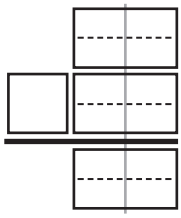

☐ clumps

5

☐	☐		☐	☐
17	429	869	127	23
+63	+320	−137	+567	+73
____	____	____	____	____

6 **What part of the mailboxes are closed?**

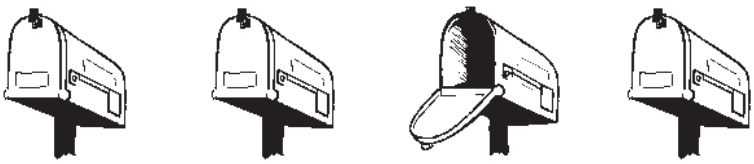

$\frac{2}{3}$ ○ $\frac{1}{4}$ ○ $\frac{3}{4}$ ○

7

1 yard = ____ inches | 1 yard = ____ feet | 1 foot = ____ inches

8

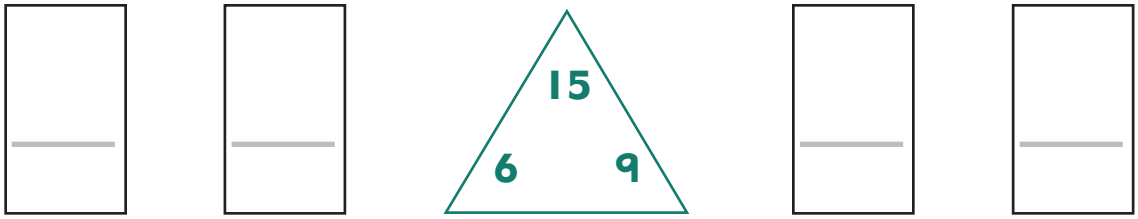

9

13 – 9 = ____	9 + 4 = ____	14 – 6 = ____	6 + 9 = ____
7 + 7 = ____	14 – 8 = ____	8 + 6 = ____	13 – 6 = ____

10 **How many cents?**

- ○ fifty-eight cents
- ○ forty-three cents
- ○ forty-eight cents
- ○ fifty-four cents

11

13	5	14	9
– 8	+ 8	– 5	+ 5
____	____	____	____
6	14	5	8
+ 7	– 9	+ 9	+ 5
____	____	____	____

12 **Solve the problems.**

6 + 7 – 5 = ____

12 – 6 + 8 = ____

14 – 7 + 4 = ____

No New Facts

154 One Hundred Fifty-four

During the first 7 months of school, Harold memorized 100 Bible verses. In the rest of the school year, he wants to memorize 54 more. How many verses does Harold plan to memorize this year?

$$\begin{array}{r} \square \\ + \quad \square \\ \hline \square \end{array} \text{ verses}$$

❶ **New Facts**

$15 - 9 = \square$

$15 - 6 = \square$

❷

- ○ fifty-five
- ○ five-fifty
- ○ fifty-four

- ○ eighty-seven
- ○ ninety-eight
- ○ eighty-nine

❸ **Story Problem**

Mark set up a roadside stand to sell flowers from Mother's garden. He earned 10 cents the first day. The second day he spent 5 cents on a piece of gum. On the third day, he earned 7 cents. How much money has he saved?

4



I Can Do This

5

15 – 6 =	4 + 9 =
6 + 9 =	14 – 8 =
12 – 6 =	8 + 5 =
7 + 6 =	13 – 6 =

6 Write <, >, or =.

14 – 7 ☐ 5

13 – 9 + 2 ☐ 5

832 ☐ 841

7 A dollar is equal to how many cents?

8

☐	☐		☐	☐
64	26	894	244	39
+32	+14	–643	+133	+44

9

13	6	14	7	15	9	14	8
− 8	+ 8	− 5	+ 7	− 9	+ 6	− 7	+ 6

10 **Measure the length of the hippopotamus in centimetres.**

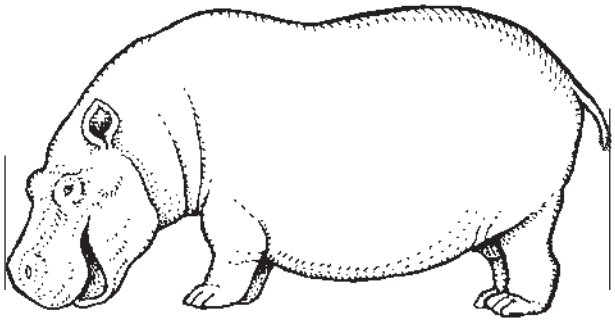

centimetres

11 **Write the amounts.**

344¢ = **6¢ =** **450¢ =**

12

5 + 9 = 14 − 6 = 5 + 8 = 13 − 5 =

14 − 9 = 9 + 5 =

13 − 7 = 6 + 7 =

No New Facts